Counting Coins: Medium

Add quarters. Totals under 60¢.

Name: _____ Date: _____

Count the coins. Write the total. Tip: start with the coin worth the most.

1.  = _____

2.  = _____

3.  = _____

4.  = _____

5.  = _____

6.  = _____

7.  = _____

8.  = _____

9.  = _____

Counting Coins: Medium (Answer Key)

Add quarters. Totals under 60¢.

Count the coins. Write the total. Tip: start with the coin worth the most.

1.  = 45¢

2.  = 42¢

3.  = 40¢

4.  = 35¢

5.  = 32¢

6.  = 17¢

7.  = 45¢

8.  = 36¢

9.  = 31¢