Counting Coins: Hard

Five to seven coins. Totals under $1.

Name: _____ Date: _____

Count the coins. Write the total. Tip: start with the coin worth the most.

1.  = _____

2.  = _____

3.  = _____

4.  = _____

5.  = _____

6.  = _____

7.  = _____

8.  = _____

9.  = _____

Counting Coins: Hard (Answer Key)

Five to seven coins. Totals under $1.

Count the coins. Write the total. Tip: start with the coin worth the most.

1.  = 71¢

2.  = 58¢

3.  = 42¢

4.  = 42¢

5.  = 56¢

6.  = 51¢

7.  = 42¢

8.  = 80¢

9.  = 63¢