# Counting Coins: Easy

Pennies, nickels, and dimes. Totals under 30¢.

Name: _____ Date: _____

Count the coins. Write the total. Tip: start with the coin worth the most.

1.  = _____

2.  = _____

3.  = _____

4.  = _____

5.  = _____

6.  = _____

7.  = _____

8.  = _____

9.  = _____

10.  = _____

# Counting Coins: Easy (Answer Key)

Pennies, nickels, and dimes. Totals under 30¢.

Count the coins. Write the total. Tip: start with the coin worth the most.

1.  = 16¢

2.  = 10¢

3.  = 15¢

4.  = 11¢

5.  = 3¢

6.  = 21¢

7.  = 20¢

8.  = 7¢

9.  = 7¢

10.  = 11¢